Comparing time

1 Tick the longest time in each set.

a) 1 minute | 1 second | 1 hour

b) 1 week | 1 month | 1 day

2 Tick the shortest time in each set.

a) 1 minute | 1 second | 1 hour

b) 1 week | 1 month | 1 day

3 Write >, < or = to compare the times.

1 day ◯ 1 week

7 days ◯ 1 week

1 month ◯ 1 week

4 Three children ran a race.

Ron	Kim	Sam
		
65 seconds	53 seconds	60 seconds

Complete the sentences.

a) _____ was the fastest.

b) _____ was the slowest.

c) _____ was faster than Sam.

5 Use a stopwatch to compare how long each activity takes.

- Counting to 10
- Writing your name 3 times.
- Building a tower of 10 cubes.

Use these words and phrases.

fastest | slowest | faster than | slower than

© White Rose Maths 2020